PREVIOUS YEAR PAPER

SSC CGL 2020 Tier I — 13 August 2021, Shift 1

SSC CGL · 13 August 2021 · 9:00 AM - 10:00 AM

90 of the paper's 100 questions · +2 for a correct answer, −0.5 for a wrong one · 60 minutes

Left out of the original paper: 10 (any question that needs a figure or formatting we cannot show, has no answer in the response sheet, or could not be checked against a second copy of the paper).

Questions from the Staff Selection Commission's paper of 13 August 2021, 9:00 AM - 10:00 AM. Each question is followed by its answer, and the answer key is repeated on the last page.

Take it as a timed practice test: exambharo.com/ssc-cgl/previous-year-papers/ssc-cgl-2020-tier-1-13-aug-shift-1/

General Intelligence and Reasoning

2. Select the option in which the words share the same relationship as that shared by the given pair of words. Horses : Neigh

(a) Ducks : Quack

(b) Parrots : Bray

(c) Hares : Boom

(d) Pigs : Buzz

Answer: (a)

3.

Select the option figure that is embedded in the given figure (rotation is NOT allowed).

(a)

(b)

(c)

(d)

Answer: (b)

4. Four words have been given, out of which three are alike in some manner and one is different. Select the word that is different.

(a) Intelligence

(b) Weight

(c) Aptitude

(d) Memory

Answer: (b)

5. Read the given statements and conclusions carefully. Assuming that the information given in the statements is true, even if it appears to be at variance with commonly known facts, decide which of the given conclusions logically follow(s) from the statements. Statements: All polygons are angles. All angles are diagonals. All cones are cubes. All cubes are decagons. No diagonal is a cube.
Conclusions:
I. Some diagonals are polygons.
II. All diagonals are decagons.
III. No polygon is a cone.
IV. Some cubes are angles.

(a) Both conclusions I and III follow

(b) Both conclusions I and II follow

(c) Only conclusion I follows

(d) Both conclusions II and IV follow

Answer: (a)

6. Select the correct combination of mathematical signs that can sequentially replace the * signs and balance the given equation. 42 * 7 * 64 * 11 * 6 *4

(a) ÷, –, +, ×, =

(b) ×, +, –, ÷, =

(c) ÷, +, –, ×, =

(d) ×, –, +, ÷, =

Answer: (c)

7. Four number-pairs have been given, out of which three are alike in some manner and one is different. Select the number-pair that is different.

(a) 14 : 210

(b) 18 : 342

(c) 17 : 307

(d) 12 : 156

Answer: (c)

8. Select the number from among the given options that can replace the question mark (?) in the following series. 24, 35, 51, 73, 102, ?

(a) 149

(b) 131

(c) 151

(d) 139

Answer: (d)

9. In a certain code language, 'AROUND' is coded as '52182412144' and 'FIX' is coded as '63624'. How will 'PLASTIC' be coded in that language?

(a) 1612261920183

(b) 1612522021363

(c) 1812521920383

(d) 1612521920363

Answer: (d)

10. Select the option that is related to the third word in the same way as the second word is related to the first word. Depression : Mood :: Insomnia : ?

(a) Sleep

(b) Thinking

(c) Night

(d) Dreams

Answer: (a)

11. Select the combination of letters that when sequentially placed in the blanks of the given series will complete the series. L_UA_Z_N_AP_L_U_PZ

(a) N, L, P, A, N, U, Z

(b) P, N, L, Z, U, A, N

(c) P, L, U, Z, N, A, N

(d) N, P, L, U, Z, N, A

Answer: (d)

14. Out of the total number of players, 100/3 % are in hotel X and the remaining are in hotel Y. If 20 players from hotel Y are shifted to hotel X, then the number of players in hotel X becomes 50% of the total number of players. If 20 players from hotel X are shifted to hotel Y, then the number of players in hotel X becomes what per cent of the total number of players?

(a) 20.67%

(b) 16.67%

(c) 26.34%

(d) 12.75%

Answer: (b)

15. Four letter-clusters have been given, out of which three are alike in some manner and one is different. Select the letter-cluster that is different.

(a) TPLH

(b) NJFA

(c) CYUQ

(d) FBXT

Answer: (b)

16.

The sequence of folding a piece of paper and the manner in which the folded paper has been cut is shown in the following figures. How would this paper look when unfolded?

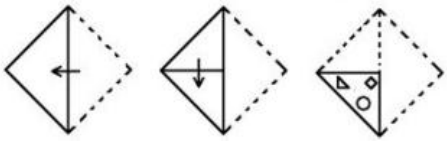

(a)



(b)



(c)

(d)



Answer: (d)

19. Study the given pattern carefully and select the number that can replace the question mark (?) in it. 4 7 6 15 ? 21 44 68 60

(a) 19

(b) 20

(c) 18

(d) 24

Answer: (d)

20. P, L, T, B, N and D are six members of a business family. N is the son of B, who is not the mother of N. L is the brother of B. D and B are a married couple. T is the daughter of D, who is the sister of P. How is N related to T?

(a) Sister

(b) Father

(c) Brother

(d) Mother

Answer: (c)

21. Select the letter-cluster from among the given options that can replace the question mark (?) in the following series. PNNA, RPPE, TRRI, VTTO, ?

(a) YVVU

(b) XWWU

(c) XVVU

(d) YUUV

Answer: (c)

22. In a certain code language, 'PERMIT' is written as 'VVLNOG'. How will 'INERTIA' be written in that language?

(a) XYOHBCU

(b) OMYIZRU

(c) OHYXZCU

(d) XOYHCZU

Answer: (b)

23. Select the option that is related to the third number in the same way as the second number is related to the first number. 12 : 60 :: 16 : ?

(a) 210

(b) 121

(c) 112

(d) 201

Answer: (c)

24. Select the option in which the numbers are related in the same way as are the numbers of the following set. (25, 18, 225)

(a) (9, 16, 170)

(b) (24, 22, 264)

(c) (15, 34, 190)

(d) (17, 15, 220)

Answer: (b)

25.

Select the Venn diagram that best illustrates the relationship among the following classes.

Women, Researchers, Introverts

(a)

(b)



(c)

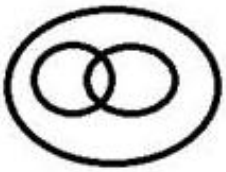

(d)

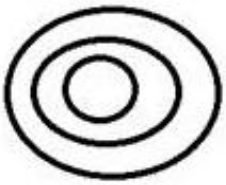

Answer: (a)

General Awareness

1. Who among the following was elected as the President of Veterinary Council of India in January 2021?

(a) Rajeev Arora

(b) Dipankar Seth

(c) Umesh Sharma

(d) KK Verma

Answer: (c)

2. Which of the following statements about Swami Dayanand Saraswati is INCORRECT?

(a) He authored the book 'Satyarth Prakash'.

(b) He was the founder of Arya Samaj.

(c) His birthplace was Gujarat.

(d) He was the founder of Brahmo Samaj.

Answer: (d)

3. Who among the following had written Kitab-ul-Hind that gave an incisive description of early 11th Century India?

(a) Al-Bukhari

(b) Al-Khwarizmi

(c) Al-Biruni

(d) Al-Kindi

Answer: (c)

4. Which of the following is the application of sciences such as physics, chemistry, biology, computer science and engineering to matters of law and to the identification of various facts of civilian investigation?

(a) Psychology

(b) Morphology

(c) Forensic science

(d) Kalology

Answer: (c)

5. As per the Union Budget of 2021-22, how many regional national institutes of virology will be set up?

(a) Six

(b) Two

(c) Three

(d) Four

Answer: (d)

6. In Leh, the first ever ice climbing festival w[illegible]brated in _____ valley in January 2021.

(a) Nubra

(b) Ripchar

(c) Markha

(d) Dras

Answer: (a)

7. Which of the following places is famous for a copper mine?

(a) Khetri

(b) Keonjhar

(c) Gaya

(d) Satna

Answer: (a)

8. Who among the following was one of the founders of the Hindustan Republic Association?

(a) Jatindranath Mukherjee

(b) Ram Prasad Bismil

(c) Surya Sen

(d) Lala Lajpat Rai

Answer: (b)

9. In which of the following years was the Planning Commission of India set up?
   (a) 1962
   (b) 1945
   (c) 1950
   (d) 1958
   Answer: (c)

10. Baghmara Pitcher Plant Sanctuary is located in which of the following states?
   (a) Assam
   (b) Karnataka
   (c) Goa
   (d) Meghalaya
   Answer: (d)

11. In December 2020, the Ministry of Home Affairs declared the entire State of _____ as a 'disturbed area' for six more months under the Armed Forces (Special Powers) Act, 1958 (AFSPA).
   (a) Jharkhand
   (b) Punjab
   (c) Nagaland
   (d) West Bengal
   Answer: (c)

12. Who among the following won the '3rd Rabindrar Tagore Literary Prize' for his novel 'The City and The Sea' in December 2020?
   (a) Raj Kamal Jha
   (b) Shekhar Gupta
   (c) Siddhartha Sarma
   (d) Rajdeep Sardesai
   Answer: (a)

13. In which of the following years was the Second Round Table Conference in London held?
   (a) 1931
   (b) 1941
   (c) 1939
   (d) 1925
   Answer: (a)

14. Unique Transaction Reference number is a _____ character code used to uniquely identify a transaction in the RTGS system.
   (a) 34
   (b) 45
   (c) 22
   (d) 17
   Answer: (c)

15. Who among the following is a Padma Vibhushan awardee of 2021?
    (a) Sudarshan Sahoo
    (b) Tarlochan Singh
    (c) Mouma Das
    (d) Sumitra Mahajan

    Answer: (a)

16. Which of the following is NOT a town/city on the west coast of India?
    (a) Surat
    (b) Gopalpur
    (c) Karwar
    (d) Mangalore

    Answer: (b)

17. Which of the following is a process in which hot, less dense materials rise upward and are replaced by colder, more dense materials?
    (a) Condensation
    (b) Radiation
    (c) Conduction
    (d) Convection

    Answer: (d)

18. Who among the following replaced Morarji Desai the Prime Minister of India in 1979?
    (a) Jagjivan Ram
    (b) Charan Singh
    (c) Chandrasekhar
    (d) Devi Lal

    Answer: (b)

19. Which of the following has the same dimension as that of linear momentum?
    (a) Impulse
    (b) Work
    (c) Stress
    (d) Energy

    Answer: (a)

20. Gurdwara Patalpuri Sahib is located on the bank of river _____.
    (a) Ganga
    (b) Sutlej
    (c) Yamuna
    (d) Beas

    Answer: (b)

21. Who won the Toyota Thailand Open Women's Singles Title in Bangkok in January 2021?
    (a) Ashwini Ponnappa
    (b) Carolina Marin
    (c) Tai Tzu-ying
    (d) PV Sindhu

    Answer: (b)

22. Which of the following schemes is aimed at helping accelerate the uptake of broadband internet services?
    (a) PM-DHWANI
    (b) PM-INTERNET
    (c) PM-WANI
    (d) PM-VAARTA

    Answer: (c)

23. _____ is the structural and functional unit of kidney.
    (a) Nephron
    (b) Cortex
    (c) Ureter
    (d) Medulla

    Answer: (a)

24. Electron-volt is a unit of _____.
    (a) current
    (b) power
    (c) potential difference
    (d) energy

    Answer: (d)

25. For which of the following franchise teams did AB de Villiers play in IPL 2020?
    (a) Delhi Capitals
    (b) Royal Challengers Bangalore
    (c) Kolkata Knight Riders
    (d) Mumbai Indians

    Answer: (b)

Quantitative Aptitude

3.

If $\frac{\cos^2\theta}{\cot^2\theta+\sin^2\theta-1} = 3,\ 0° < \theta < 90°$, then the value of $(\tan\theta + \operatorname{cosec}\theta)$ is:

(a)

$\frac{5\sqrt{3}}{3}$

(b)

$3\sqrt{3}$

(c)

$2\sqrt{3}$

(d)

$\frac{4\sqrt{3}}{3}$

Answer: (a)

4.

If $8(x+y)^3 - 27(x-y)^3 = (5y-x)(Ax^2+By^2+Cxy)$, then what is the value of (A+B - C)?

(a)

16

(b)

36

(c)

-26

(d)

-16

Answer: (b)

5.

If $x + y = 4$ and $\frac{1}{x} + \frac{1}{y} = \frac{16}{15}$, then what is the value of $(x^3 + y^3)$?

(a)

18

(b)

16

(c)

19

(d)

21

Answer: (c)

6.

$\triangle ABC \sim \triangle PQR$. The areas of $\triangle ABC$ and $\triangle PQR$ are 64 cm^2 and 81 cm^2, respectively and AD and PT are the medians of $\triangle ABC$ and $\triangle PQR$, respectively. If $PT = 10.8\ cm$, then $AD = ?$

(a)

$8.4\ cm$

(b)

$9\ cm$

(c)

$9.6\ cm$

(d)

$12\ cm$

Answer: (c)

8.

Study the table and answer the question.

Table shows District-wise data of the number of primary school teachers posted in schools of a city.

District	Male teachers	Female teachers
East	1650	2375
North	1075	2651
West	1280	1520
South	1170	1085
Central	690	859

What is the ratio of the number of male teachers to the [illegible] female teachers in the city?

(a)

586 : 849

(b)

391 : 566

(c)

78 : 113

(d)

195 : 283

Answer: (b)

9.

X, Y are two points in a river. Points P and Q divide the straight line XY into three equal parts. The river flows along XY and the time taken by a boat to row from X to Q and from Y to Q are in the ratio 4 : 5. The ratio of the speed of the boat downstream to that of the river current is equal to:

(a)

3 : 10

(b)

10 : 3

(c)

3 : 4

(d)

4 : 3

Answer: (b)

10.

When x is subtracted from each of 19, 28, 55 and 91, the numbers so obtained in this order are in proportion. What is the value of x?

(a)

8

(b)

7

(c)

9

(d)

5

Answer: (b)

11.

$\frac{\operatorname{cosec}\theta}{\operatorname{cosec}\theta-1}+\frac{\operatorname{cosec}\theta}{\operatorname{cosec}\theta+1}-\tan^2\theta,\ 0^\circ<\theta<90^\circ,$
is equal to:

(a)

$\sec^2\theta+1$

(b)

$\sec^2\theta$

(c)

$2\sec^2\theta$

(d)

$1-\tan^2\theta$

Answer: (a)

12.

The income of A is 45% more than the income of B and the income of C is 60% less than the sum of the incomes of A and B. The income of D is 20% more than that of C. If the difference between the incomes of B and D is ₹13200, then the income (in ₹) of C is:

(a)

72000

(b)

72500

(c)

73500

(d)

75000

Answer: (c)

13.

Length of each side of a rhombus is 13 cm and one of the diagonal is 24 cm. What is the area (in cm^2) of the rhombus?

(a)

120

(b)

300

(c)

60

(d)

240

Answer: (a)

14.

Study the following table and answer the question:

Number of cars sold by dealers A, B, C, D & E during first six months of 2018.

Month / Dealer	January	February	March	April	May	June
A	620	640	628	635	430	625
B	600	642	635	580	450	620
C	640	635	640	540	625	740
D	520	645	722	740	600	780
E	548	638	720	740	650	800

In July 2018, if the sales of cars by the dealer D increases by the same percentage as in June 2018 over its previous month, then what is the number of cars sold by D in July 2018?

(a)

1020

(b)

959

(c)

1014

(d)

975

Answer: (c)

15.

Sides AB and DC of a cyclic quadrilateral ABCD are produced to meet [illegible] sides AD and BC are produced to meet at F. If $\angle ADC = 78°$ and $\angle BEC = 52°$, then the measure of $\angle AFB$ is:

(a)

$28°$

(b)

$26°$

(c)

$32°$

(d)

$30°$

Answer: (a)

16.

Study the table and answer the question.

In the table, production and sale (in 1000 tonnes) of a certain product of a company over 5 years is given.

years	Production (in 1000 tonnes)	Sale (in 1000 tonnes)
2015	1250	1000
2016	1400	1290
2017	1450	1100
2018	1500	1450
2019	1600	1390

In which year(s) sale is more than 90% of the production?

(a)

2015, 2017, 2019

(b)

2017, 2018

(c)

2016, 2017

(d)

2016, 2018

Answer: (d)

18.

Some fruits are bought at 15 for ₹140 and an equal number of fruits at 10 for ₹120. If all the fruits are sold at ₹132 per dozen, then what is the profit percent in the entire transaction?

(a)

$3\frac{1}{8}$

(b)

$4\frac{1}{2}$

(c)

$2\frac{1}{4}$

(d)

3

Answer: (a)

19.

What is the compound interest (in ₹) on a sum of ₹8192 for $1\frac{1}{4}$ years at 15% per annum, if interest is compounded 5- monthly?

(a)

1634

(b)

1740

(c)

1735

(d)

1640

Answer: (a)

21.

If $x + \frac{1}{x} = 4$, then the value of $x^5 + \frac{1}{x^5}$ is:

(a)

776

(b)

684

(c)

724

(d)

736

Answer: (c)

22.

The average of 28 numbers is 77. The average of first 14 numbers is 74 and the average of last 15 numbers is 84. If the 14th number is excluded, then what is the average of remaining numbers? (correct to one decimal places)

(a)

76.9

(b)

77

(c)

73.1

(d)

74.7

Answer: (d)

23.

The value of $20 \div 5\ of\ 8 \times [9 \div 6 \times (6-3)] - (10 \div 2\ of\ 20)$ is:

(a)
1

(b)
2

(c)
0

(d)
6

Answer: (b)

24.

If the 5-digit number $676xy$ is divisible by 3, 7 and 11, then what is the value of $(3x - 5y)$?

(a)
10

(b)
11

(c)
9

(d)
7

Answer: (c)

25.

A shopkeeper earns a profit of 21% after selling a book at 21% discount on the printed price. The ratio of the cost price and selling price of the book is:

(a)
79 : 100

(b)
100 : 79

(c)
121 : 100

(d)
100 : 121

Answer: (d)

English Comprehension

1. Select the option that expresses the given sentence in passive voice. The invigilator is advising the students not to carry calculators into the examination hall.

(a) The students are being advised by the invigilator not to carry calculators into the examination hall.

(b) The students have been advised not to carry calculators into the examination hall by the invigilator.

(c) The students were advised not to carry calculators into the examination hall.

(d) The students were advised the invigilator not to carry calculators into the examination hall.

Answer: (a)

2. Select the most appropriate option to fill in the blank. India is formally moving ahead to _____ 21 MIG-29 and 12 Sukhoi-30MKI fighters from Russia along with upgrades of their existing fleets.

(a) accomplish

(b) achieve

(c) advance

(d) procure

Answer: (d)

3. Sentences of a paragraph are given below in jumbled order. Arrange the sentences in the right order to form a meaningful and coherent paragraph.
A. But the eagle, in wrath, gave the beetle a flap of his wing, and straightaway seized upon the hare and devoured him.
B. The beetle therefore interceded with the eagle, begging of him not to kill the poor suppliant, and pleaded with him not to kill so small an animal.
C. When the eagle flew away, the beetle flew after him, to learn where his nest was.
D. A hare, being pursued by an eagle, took himself for refuge to the nest of a beetle, whom he begged to save him.

(a) ACDB

(b) DCAB

(c) CBAD

(d) DBAC

Answer: (d)

4. Select the most appropriate meaning of the given idiom. Bang for the buck

(a) A sorrowful heart

(b) More value for money

(c) Dash against something

(d) Less value for money

Answer: (b)

5. Select the option that expresses the given sentence in indirect speech. “Everything is going to be alright,” said the doctor.

(a) The doctor said that everything are going to be alright.
(b) The doctor said that everything will be alright.
(c) The doctor said that everything was going to be alright.
(d) The doctor said that everything is going to be alright.

Answer: (c)

6. Select the most appropriate synonym of the given word. Generic

(a) Specific
(b) Definite
(c) Universal
(d) Precise

Answer: (c)

7. Select the most appropriate meaning of the given idiom. Raise the bar

(a) To grow taller
(b) To set higher goals
(c) To win a competition
(d) To raise the price

Answer: (b)

8. Select the option that can be used as a one-word substitute for the given group of words. A herd or flock of animals being driven in a body

(a) Crowd
(b) Cluster
(c) Throng
(d) Drove

Answer: (d)

9. Select the most appropriate synonym of the given word. Regime

(a) Country
(b) Rule
(c) Territory
(d) Space

Answer: (b)

10. Select the most appropriate option to substitute the underlined segment in the given sentence. If no substitution is required, select 'No substitution'.

The toy drummer plays the drum if you press the button at the back.

(a) will play the drum if you will press
(b) playing the drum if you pressed
(c) played the drum if you are pressing
(d) No substitution

Answer: (d)

11. Select the INCORRECTLY spelt word.

(a) Unmanageable
(b) Wildernesses
(c) Voilence
(d) Exterminated

Answer: (c)

12. Select the most appropriate ANTONYM of the given word. Gradual

(a) Abrupt
(b) Slow
(c) Regular
(d) Gentle

Answer: (a)

13. Sentences of a paragraph are given below in jumbled order. Arrange the sentences in the right order to form a meaningful and coherent paragraph.
A. When we got near, we saw it was the steam rising from hot springs.
B. We saw in the distance a great column of smoke.
C. We wondered if it came from a chimney or a burning house.
D. We thought of taking a bath in the hot water.

(a) BCDA
(b) ABCD
(c) BCAD
(d) ACDB

Answer: (c)

14. Select the most appropriate option to fill in the blank. Work and domestic _____ made Kajal short-tempered.

(a) pressures
(b) weights
(c) gravities
(d) forces

Answer: (a)

15. Select the INCORRECTLY spelt word.

(a) Pieceful

(b) Creature

(c) Specified

(d) Decrease

Answer: (a)

16. Select the most appropriate ANTONYM of the given word. Seize

(a) Grab

(b) Catch

(c) Snatch

(d) Loosen

Answer: (d)

17. The following sentence has been divided into parts. One of them contains an error. Select the part that contains the error from the given options. You must avoid riding in a crowded bus / or travelling in a metro / during rush hour / as both are quiet unpleasant experiences.

(a) as both are quiet unpleasant experiences

(b) during rush hour

(c) or travelling in a metro

(d) You must avoid riding in a crowded bus

Answer: (a)

18. The following sentence has been split into four segments. Identify the segment that contains a grammatical error. Had you / not reached in time, / we will have / lost our lives.

(a) Had you

(b) lost our lives

(c) not reached in time

(d) we will have

Answer: (d)

19. Select the most appropriate option to substitute the underlined segment in the given sentence. If no substitution is required, select 'No substitution'.

While washing your hands, rub them together for 20 seconds to remove <u>the microbes</u> <u>on them.</u>

(a) the microbes on their

(b) the microbes on those

(c) the microbes on they

(d) No substitution

Answer: (d)

20. Select the option that can be used as a one-word substitute for the given group of words. A group of three novels or plays, each complete in itself

(a) Triplet

(b) Trivet

(c) Triumvir

(d) Trilogy

Answer: (d)

Passage — for questions 21–25

> In the following passage, some words have been deleted. Fill in the blanks with the help of the alternatives given. Select the most appropriate option for each blank.
>
> What every tourist must take back from Bhutan is pure honey, especially Putka, “Antibiotic” honey produced (1)_____ Melipona Bees (stingless bees) a breed found in protected areas (2)_____ 700 to 1,500 metres above sea level. Due (3)_____ their small size, they can get larger nutrients (4)_____ regular honeybees. It has a tangy/sour taste and can (5)_____ your sore throat in a matter of minutes.

21. Select the most appropriate option to fill in blank number 1.

(a) of

(b) through

(c) by

(d) with

Answer: (c)

22. Select the most appropriate option to fill in blank number 2.

(a) midst

(b) after

(c) between

(d) among

Answer: (c)

23. Select the most appropriate option to fill in blank number 3.

(a) for

(b) at

(c) to

(d) of

Answer: (c)

24. Select the most appropriate option to fill in blank number 4.

(a) then

(b) than

(c) though

(d) and

Answer: (b)

25. Select the most appropriate option to fill in blank number 5.
    (a) pacify
    (b) appease
    (c) soothe
    (d) calm
    Answer: (c)

Answer key

Answer key as marked in the Staff Selection Commission's response sheet. "—" means the sheet did not show it clearly.

General Intelligence and Reasoning

2	**(a)**	3	**(b)**	4	**(b)**	5	**(a)**	6	**(c)**	7	**(c)**	8	**(d)**	9	**(d)**
10	**(a)**	11	**(d)**	14	**(b)**	15	**(b)**	16	**(d)**	19	**(d)**	20	**(c)**	21	**(c)**
22	**(b)**	23	**(c)**	24	**(b)**	25	**(a)**								

General Awareness

1	**(c)**	2	**(d)**	3	**(c)**	4	**(c)**	5	**(d)**	6	**(a)**	7	**(a)**	8	**(b)**
9	**(c)**	10	**(d)**	11	**(c)**	12	**(a)**	13	**(a)**	14	**(c)**	15	**(a)**	16	**(b)**
17	**(d)**	18	**(b)**	19	**(a)**	20	**(b)**	21	**(b)**	22	**(c)**	23	**(a)**	24	**(d)**
25	**(b)**														

Quantitative Aptitude

3	**(a)**	4	**(b)**	5	**(c)**	6	**(c)**	8	**(b)**	9	**(b)**	10	**(b)**	11	**(a)**
12	**(c)**	13	**(a)**	14	**(c)**	15	**(a)**	16	**(d)**	18	**(a)**	19	**(a)**	21	**(c)**
22	**(d)**	23	**(b)**	24	**(c)**	25	**(d)**								

English Comprehension

1	**(a)**	2	**(d)**	3	**(d)**	4	**(b)**	5	**(c)**	6	**(c)**	7	**(b)**	8	**(d)**
9	**(b)**	10	**(d)**	11	**(c)**	12	**(a)**	[illegible]	**(c)**	14	**(a)**	15	**(a)**	16	**(d)**
17	**(a)**	18	**(d)**	19	**(d)**	20	[illegible]	[illegible]	**(c)**	22	**(c)**	23	**(c)**	24	**(b)**
25	**(c)**														