PREVIOUS YEAR PAPER

SSC CGL 2018 Tier I — 12 June 2019, Shift 3

SSC CGL · 12 June 2019 · 4:00 PM - 5:00 PM

100 questions · +2 for a correct answer, −0.5 for a wrong one · 60 minutes

Questions from the Staff Selection Commission's paper of 12 June 2019, 4:00 PM - 5:00 PM. Each question is followed by its answer, and the answer key is repeated on the last page.

Take it as a timed practice test: exambharo.com/ssc-cgl/previous-year-papers/ssc-cgl-2018-tier-1-12-jun-shift-3/

General Intelligence and Reasoning

1.

Select the figure in which the given figure is embedded.
(Rotation is not allowed).

(a)

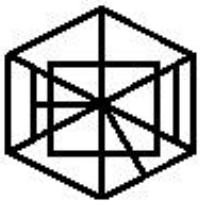

(b)

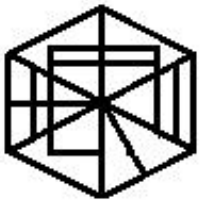

(c)

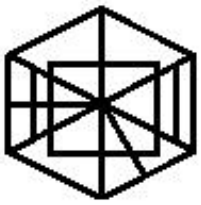

(d)

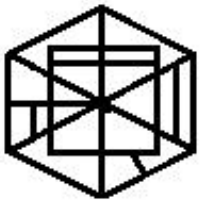

Answer: (c)

2.

Three of the following four number-pairs are alike in a certain way and one is different. Pick the number-pair that is different from the rest.

(a)

4 : 65

(b)

1 : 2

(c)

3 : 27

(d)

2 : 9

Answer: (c)

3.

'A + B' means 'A is the wife of B'.
'A – B' means 'A is the husband of B'.
'A × B' means 'A is the son of B'.
'A ÷ B' means 'A is the mother of B'.

If T + Q × P – U ÷ R ÷ S + V, then how is R related to Q?

(a)

Daughter

(b)

Maternal grandmother

(c)

Sister

(d)

Mother

Answer: (c)

4.

Which number will replace the question mark (?) in the following series?

102, 110, 126, 150, 182, ?

(a)
246

(b)
214

(c)
220

(d)
222

Answer: (d)

5.

Select the figure that will come next in the following figure series.

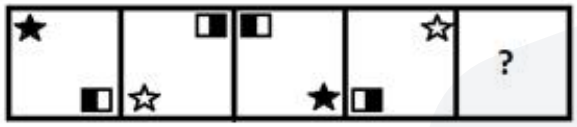

(a)

(b)

(c)

(d)

Answer: (b)

6.

Arrange the following words in a logical and meaningful order.

1. Ploughing up the field
2. Bread making
3. Production of wheat
4. Wheat grinding
5. Sowing the seeds
6. Dough making

(a)

1, 5, 3, 4, 6, 2

(b)

2, 5, 3, 4, 1, 6

(c)

1, 5, 3, 6, 4, 2

(d)

4, 5, 2, 6, 1, 3

Answer: (a)

7.

Which letter will replace the question mark (?) in the following series?

D, J, ?, S, V, X

(a)

O

(b)

M

(c)

P

(d)

Q

Answer: (a)

8.

Which letter-cluster will replace the question mark (?) in the following series?

SWA, OAW, KES, ?, CMK

(a)
GIO

(b)
GHO

(c)
FIP

(d)
FIO

Answer: (a)

9.

In a code language, CLIMAX is written as 312913124. How will RESIGN be written as in that language?

(a)
185199714

(b)
185198614

(c)
195209714

(d)
185199713

Answer: (a)

10.

Three of the following four words are alike in a certain way and one is different. Pick the odd word out.

(a)
Diabetes

(b)
Frustration

(c)
Anaemia

(d)
Hypertension

Answer: (b)

11.

Three of the following four letter-clusters are alike in a certain way and one is different. Pick the odd one out.

(a)

ZXUQL

(b)

NLHDC

(c)

SQNJE

(d)

PNKGB

Answer: (b)

12.

The sum of the current ages of Vinayak and his father is 50 years. 5 years from now, Vinayak's age will be one-fifth of his father's age. What is Vinayak's current age?

(a)

15 years

(b)

5 years

(c)

8 years

(d)

10 years

Answer: (b)

13.

Two statements are given, followed by three conclusions numbered I, II and III. Assuming the statements to be true, even if they seem to be at variance with commonly known facts, decide which of the conclusions logically follow(s) from the statements.

Statements:
All owls are parrots.
Some parrots are crows.

Conclusions:
I. No owl is a crow.
II. All parrots are owls.
III. Some owls are crows.

(a)

All the conclusions, I, II and III, follow

(b)

Only conclusions II and III follow.

(c)

Either conclusion I or III follows

(d)

Either conclusion I or II follows

Answer: (c)

14.

Select the option that depicts how the given transparent sheet of paper would appear if it is folded at the dotted line.

(a)

(b)

(c)

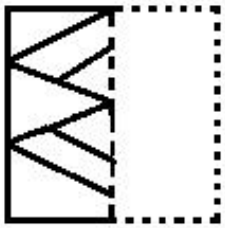

(d)

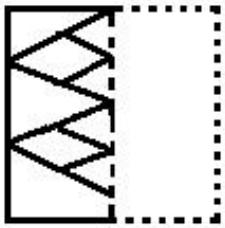

Answer: (a)

15.

Select the correct mirror image of the given figure when a vertical mirror is placed on the right of the figure.

(a)

(b)

(c)

(d)

Answer: (b)

16.

In a code language, DISTRIBUTION is written as SIDIRTTUBNOI. How will ABBREVIATING be written as in that language?

(a)
BBAVERIATGNI

(b)
VERBBAGNITAI

(c)
BBAVERTAIGNI

(d)
BABRVEAIITGN

Answer: (c)

17.

How many triangles are there in the following figure?

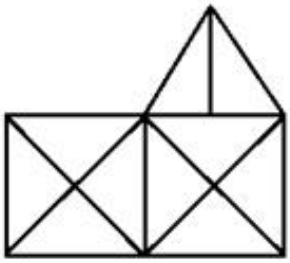

(a)
21

(b)
23

(c)
19

(d)
20

Answer: (a)

18.

Select the word-pair in which the two words are related in the same way as the two words in the following word-pair.

Accident : Injury

(a)

Infection : Disease

(b)

Farmer : Hard-work

(c)

Income : Corruption

(d)

Police : Fine

Answer: (a)

19.

Which two signs should be interchanged to make the following equation correct?

$18 + 24 - 6 \times 6 \div 3 = 39$

(a)

$\div$ and $+$

(b)

$+$ and $-$

(c)

$\div$ and $-$

(d)

$\times$ and $+$

Answer: (c)

20.

'Similarity' is related to 'Difference' in the same way as 'Transparent' is related to '_____'.

(a)

Clear

(b)

Water

(c)

Lake

(d)

Turbid

Answer: (d)

21.

Select the missing number from the given options.

4	3	1
5	4	2
89	43	?

(a)
8

(b)
27

(c)
5

(d)
36

Answer: (c)

22.

Three different positions of the same dice are shown. Which symbol will be on t[illegible]ce opposite to the one having '*'?

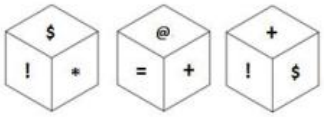

(a)
$

(b)
!

(c)
+

(d)
@

Answer: (c)

23.

Select the option that is related to the third number in the same way as the second number is related to the first number.

3 : 30 : : 4 : ?

(a)
64

(b)
66

(c)
70

(d)
68

Answer: (d)

24.

Select the missing number from the given options.

35	32	51
28	18	37
?	14	47

(a)
40

(b)
41

(c)
42

(d)
43

Answer: (a)

25.

In the given Venn diagram, the rectangle represents 'women', the pentagon represents 'entrepreneurs' and the triangle represents 'mothers'. The numbers given in the diagram represent the number of persons in that particular category.

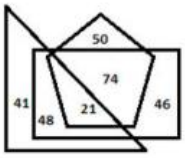

How many women are entrepreneurs but NOT mothers?

(a)
21
(b)
74
(c)
50
(d)
46

Answer: (b)

General Awareness

1. Which Indian author wrote the book 'Two Lives'?
   (a) Amitava Ghosh
   (b) Chetan Bhagat
   (c) Vikram Seth
   (d) Amish Tripathi

   Answer: (c)

2. _____ gases trap heat in the atmosphere which makes the Earth warmer, causing global warming.
   (a) Compound
   (b) Greenhouse
   (c) Nobel
   (d) Elemental

   Answer: (b)

3. Who among the following was the first Chinese to receive the Nobel Prize for literature?
   (a) Liu Cixin
   (b) Gao Xingjian
   (c) Mo Yan
   (d) Lu Xun

   Answer: (c)

4. Which team won the Indian Premier League 2018?
   (a) Royal Challengers Bangalore
   (b) Chennai Super Kings
   (c) Delhi Daredevils
   (d) Rajasthan Royals
   Answer: (b)

5. Bihar Diwas is annually celebrated on _____ to commemorate the day Bihar was carved out from the Bengal Presidency.
   (a) 22nd March
   (b) 27th March
   (c) 17th March
   (d) 13th March
   Answer: (a)

6. In March 2019, the Directorate General of Civil Aviation (DGCA) of India grounded which aircraft due to technical fault?
   (a) Boeing 777 Max 12
   (b) Boeing 737 Max 8
   (c) Boeing 787 Max 14
   (d) Boing 747 Max 9
   Answer: (b)

7. Identify the national sport of Sri Lanka.
   (a) Swimming
   (b) Volleyball
   (c) Cricket
   (d) Basketball
   Answer: (b)

8. Which human body part can well be called the 'chemical factory' of our body?
   (a) Kidneys
   (b) Stomach
   (c) Liver
   (d) Lungs
   Answer: (c)

9. A marketplace in which a final good or service is bought and sold is called _____.
   (a) Equity Market
   (b) Factor Market
   (c) Commodity Market
   (d) Product Market
   Answer: (d)

10. Opium wars were fought between the British and _____.

(a) China

(b) Bhutan

(c) Myanmar (Burma)

(d) Afghanistan

Answer: (a)

11. Rule _____ (of the Rules of Procedure and Conduct of Business in Lok Sabha) does NOT involve a formal motion before the Parliament House, hence no voting can take place after discussion on matters under this rule.

(a) 158

(b) 186

(c) 149

(d) 193

Answer: (d)

12. Which country won the South Asian Football Federation (SAFF) Women's Championship in 2019?

(a) Bhutan

(b) Nepal

(c) India

(d) Pakistan

Answer: (c)

13. Sir Thomas Roe visited the court of Mughal rule _____ as the ambassador of the King of England.

(a) Humayun

(b) Jahangir

(c) Shah Jahan

(d) Akbar

Answer: (b)

14. Which one of the following is the deepest gorge in the world?

(a) Kali Gandaki Gorge

(b) Garganta del Cares

(c) Tiger Leaping Gorge

(d) Vikos Gorge

Answer: (a)

15. Both, haemoglobin and myoglobin require _____ for formation.

(a) Calcium

(b) Vitamin B12

(c) Iron

(d) Vitamin A

Answer: (c)

16. Nitrous Oxide' is the chemical name of _____.
    (a) Laughing Gas
    (b) Mosquito Repellent
    (c) Tear Gas
    (d) Fire Extinguisher
    Answer: (a)

17. Which of the following is the longest river in Pakistan that originates from Lake Manasarovar?
    (a) Indus
    (b) Kabul
    (c) Sutlej
    (d) Chenab
    Answer: (a)

18. A scientific study of rocks that deals with their composition, texture and structure; their occurrence and distribution; and their origin in relation to physicochemical conditions is called _____.
    (a) Geology
    (b) Lithology
    (c) Geomorphology
    (d) Petrology
    Answer: (d)

19. British East India Company defeated the Portuguese in the _____.
    (a) Battle of Chamkaur
    (b) Battle of Suvali
    (c) Battle of Plassey
    (d) Battle of Buxar
    Answer: (b)

20. Which country hosted the 2019 Sultan Azlan Shah Cup hockey tournament?
    (a) Singapore
    (b) India
    (c) China
    (d) Malaysia
    Answer: (d)

21. How many provinces are there in Sri Lanka?
    (a) 9
    (b) 6
    (c) 8
    (d) 11
    Answer: (a)

22. In China, 2019 (which starts on 5 February and ends on 24 January) is the year of the _____.
    (a) Rat
    (b) Pig
    (c) Dog
    (d) Ox
    Answer: (b)

23. A _____ is not constrained by prior work.
    (a) joint venture
    (b) franchise
    (c) strategic alliance
    (d) greenfield project
    Answer: (d)

24. Tipu Sultan and British East India Company signed the Treaty of Mangalore in the year _____.
    (a) 1792
    (b) 1784
    (c) 1764
    (d) 1799
    Answer: (b)

25. In India, which of the following articles of the Constitution of India provides for the formation of a new state?
    (a) Article 1
    (b) Article 3
    (c) Article 2
    (d) Article 9
    Answer: (b)

Quantitative Aptitude

1.
If $a+b+c=7$ and $ab+bc+ca=1$, then $a^3+b^3+c^3-3abc$ is equal to:
    (a)
    322
    (b)
    325
    (c)
    412
    (d)
    422
    Answer: (a)

2.

$sec^2\ 29° - \cot^2 61° + sin^2 60° + \text{co}\,sec^2\ 30°$ is equal to:

(a)

$\frac{19}{4}$

(b)

$\frac{23}{4}$

(c)

$\frac{15}{4}$

(d)

$\frac{11}{4}$

Answer: (b)

3.

If cosec 4θ = sec $(60° - 2\theta)$, then θ is equal to:

(a)

$18°$

(b)

$25°$

(c)

$15°$

(d)

$20°$

Answer: (c)

4.

The efficiencies of A, B and C are in the ratio 2 : 5 : 3. Working together, they can compete a task in 9 days. In how many days will C alone complete 40% of that task?

(a)

14

(b)

16

(c)

15

(d)

12

Answer: (d)

5.

This table shows the percentage of students passing out of five different colleges over three years. It is given that from each college, 200 students appeared every year.

Years	Colleges				
	A	B	C	D	E
2015	68	65	80	92	72
2016	72	68	88	95	75
2017	74	77	92	98	73

What is the approximate percentage increase in the number of students pass' ut of college B in the year 2017 as compared to the previous year?

(a)

13.2%

(b)

13.4%

(c)

12.8%

(d)

13%

Answer: (a)

6.

What is the value of x so that the seven digit number $5656x52$ is divisible by 72?

(a)

5

(b)

4

(c)

7

(d)

8

Answer: (c)

7.

Walking at $\frac{3}{5}$ of his usual speed, a person reaches his office 20 minutes late than the usual time. His usual time in minutes is:

(a)

25

(b)

30

(c)

20

(d)

40

Answer: (b)

8.

Two articles are sold for ₹975 each. On one, the seller gains 30% and on the other, he loses 25%. What is the overall gain or loss percentage, correct to one decimal place?

(a)

4.9% loss

(b)

5.3% gain

(c)

4.9% gain

(d)

5.1% loss

Answer: (a)

9.

If $12\sin\theta = 5\cos\theta$, then $\sin\theta + \cos\theta - \cot\theta$ is equal to:

(a)

$\frac{139}{156}$

(b)

$-\frac{71}{65}$

(c)

$\frac{116}{156}$

(d)

$-\frac{16}{65}$

Answer: (b)

10.

This table shows the percentage of students passing out of five different colleges over three years. It is given that from each college, 200 students appeared every year.

Years	Colleges				
	A	B	C	D	E
2015	68	65	80	92	72
2016	72	68	88	95	75
2017	74	77	92	98	73

In which college the average percentage of passing students over the given three years is the least?

(a)

E

(b)

B

(c)

F

(d)

A

Answer: (b)

11.

The price of sugar is increased by 24%. A person wants to increase his expenditure by 18% only. By approximately what percent should he decrease his consumption?

(a)

4.6%

(b)

5.1%

(c)

4.8%

(d)

5.3%

Answer: (c)

12.

$\Delta ABC \sim \Delta EDF$ and $ar(\Delta ABC) : ar(\Delta DEF) = 4 : 9$. If AB = 6 cm, BC = 8 cm and AC = 10 cm, then DF is equal to:

(a)

18 cm

(b)

9 cm

(c)

15 cm

(d)

12 cm

Answer: (d)

13.

In a class of 40 students, 60% are girls. The average of the girls' marks is 72 and that of the boys is 54. What are the average marks of the whole class?

(a)

65.4

(b)

65

(c)

64.8

(d)

65.2

Answer: (c)

14.

This table shows the percentage of students passing out of five different colleges over three years. It is given that from each college, 200 students appeared every year.

Years	Colleges				
	A	B	C	D	E
2015	68	65	80	92	72
2016	72	68	88	95	75
2017	74	77	92	98	73

What is the ratio of the number of students passing to those failing from college E in the year 2015?

(a)

4 : 3

(b)

18 : 7

(c)

9 : 5

(d)

17 : 7

Answer: (b)

15.

The value of:

$108 \div 36 \times 4 + 2.5 \times 4 \div 0.5 - 10$

(a)

18

(b)

16

(c)

22

(d)

20

Answer: (c)

16.

In a circle with centre O, an arc ABC subtends an angle of 140° at the centre of the circle. The chord AB is produced to point P. Then $\angle CBP$ is equal to:

(a)

$40°$

(b)

$70°$

(c)

$80°$

(d)

$50°$

Answer: (b)

17.

If a : b = 2 : 5, c : b = 3 : 4, then a : b : c is equal to:

(a)

6 : 15 : 20

(b)

8 : 20 : 15

(c)

2 : 5 : 4

(d)

2 : 5 : 3

Answer: (b)

18.

In ΔABC, P is a point on BC such the BP : PC = 4 : 3 and Q is the midpoint of BP. Then ar(ΔABQ) : ar(ΔACB) is equal to:

(a)

1 : 5

(b)

2 : 7

(c)

3 : 7

(d)

4 : 7

Answer: (b)

19.

The difference between the compound interest and simple interest on ₹x at 7% per annum for 2 years is ₹24.50. What is the value of x?

(a)

5,400

(b)

4,800

(c)

5,000

(d)

6,000

Answer: (c)

20.

An article is sold for ₹612 after successive discounts of 25% and x%. If the marked price of the article is ₹960, what is the value of x?

(a)

10

(b)

12

(c)

14

(d)

15

Answer: (d)

21.

If $a - b = 5$ and $ab = 2$, then $a^3 - b^3$ is equal to:

(a)

95

(b)

155

(c)

145

(d)

125

Answer: (b)

22.

This table shows the percentage of students passing out of five different colleges over three years. It is given that from each college, 200 students appeared every year.

Years	Colleges				
	A	B	C	D	E
2015	68	65	80	92	72
2016	72	68	88	95	75
2017	74	77	92	98	73

If the number of passed out students of all five colleges is represented by a pie chart, what is the central angle (to nearest whole number) of the sector representing the passed out students of college C?

(a)

$69°$

(b)

$79°$

(c)

$77°$

(d)

$67°$

Answer: (b)

23.

If $\sqrt{x} - \frac{1}{\sqrt{x}} = 3\sqrt{2}$, then $x^2 + \frac{1}{x^2}$ is

(a)

402

(b)

324

(c)

326

(d)

398

Answer: (d)

24.

A sphere of radius 4 cm is melted and recast into smaller spheres of radii 2 cm each. How many such spheres can be made?

(a)
4
(b)
8
(c)
32
(d)
16

Answer: (b)

25.

In a circle of radius 13 cm, a chord is at a distance of 12 cm from the centre of the circle. What is the length of the chord?

(a)
5 cm
(b)
7 cm
(c)
9 cm
(d)
10 cm

Answer: (d)

English Comprehension

1. In the sentence identify the segment which contains the grammatical error. There is many modes of travel to go to Agra but I prefer road travel.

(a) prefer road travel.
(b) Agra but I
(c) to go to
(d) There is many modes

Answer: (d)

2. Select the most appropriate meaning of the underlined idiom in the given sentence.

Raju was <u>playing with fire</u> when he made speeches aginst the management.

(a) taking a grave risk
(b) lighting candles
(c) smoking a cigarette
(d) provoking the crowd

Answer: (a)

3. Select the word which means the same as the group of words given. One who does not tire easily
   (a) indefatigable
   (b) inflatable
   (c) indelible
   (d) indestructible

   Answer: (a)

4. Select the most appropriate antonym of the given word. SCANTY
   (a) small
   (b) concise
   (c) profuse
   (d) precise

   Answer: (c)

5. Select the correct passive form of the given sentence. They opened a new mall nearby last month.
   (a) A new mall can be open nearby last month.
   (b) A new mall was opened nearby last month.
   (c) Nearby a new mall is opened last month.
   (d) A new mall will be opened nearby last month.

   Answer: (b)

6. Given below are four jumbled sentences. Select the option that gives their correct order.
A. When we can't laugh at the same joke again, why should we cry over the same problems?
B. One day he told them a joke and everyone became with laughter.
C. People came to a wise man to complain about the same problems every time.
D. When he repeated the joke twice, nobody laughed anymore.
   (a) DBCA
   (b) BACD
   (c) ADBC
   (d) CBDA

   Answer: (d)

7. Select the correctly spelt word.
   (a) luxury
   (b) luxry
   (c) lugzury
   (d) luxery

   Answer: (a)

8. Select the most appropriate synonym of the given word. ADEPT

(a) skilled

(b) kind-hearted

(c) alone

(d) unknown

Answer: (a)

9. Given below are four jumbled sentences. Select the option that gives their correct order.
A. The market which has remained clogged with vehicles was all clear for pedestrians.
B. The road has even been marked with stripes demarcating space for hawkers.
C. It is also lined with beautiful potted plants to give it a green look.
D. Visitors to the busy Karol Bagh market in Delhi were in for a surprise.

(a) DCBA

(b) DABC

(c) ADBC

(d) BDAC

Answer: (b)

10. Select the most appropriate meaning of the underlined idiom in the given sentence.

The authorities have <u>turned a deaf ear</u> to all our requests.

(a) acknowledged

(b) neglected

(c) accepted

(d) presented

Answer: (b)

Passage — for questions 11–15

> In the following passage some words have been deleted. Fill in the blanks with the help of the alternatives given. Select the most appropriate option for each blank.
>
> He remembers the first time he saw the elephant. "This was in 2007 at a (1) _____ called Thanni Paarai. Chinna Thambi was (2) _____ water on himself at a waterbody. The (3) _____ was green; not the kind people would drink," says Abraham. "After a nice shower, the elephant walked (4) _____ to a rock, lifted it, and drank from a (5)_____ under it."

11. Select the most appropriate option to fill in blank No.(1)

(a) place

(b) shop

(c) street

(d) market

Answer: (a)

12. Select the most appropriate option to fill in blank No.(2)
    (a) raining
    (b) wetting
    (c) sprinkling
    (d) sparkling
    Answer: (c)

13. Select the most appropriate option to fill in blank No.(3)
    (a) leaf
    (b) flower
    (c) water
    (d) milk
    Answer: (c)

14. Select the most appropriate option to fill in blank No.(4)
    (a) behind
    (b) over
    (c) above
    (d) near
    Answer: (b)

15. Select the most appropriate option to fill in blank No.(5)
    (a) tank
    (b) spring
    (c) tap
    (d) pond
    Answer: (b)

16. Select the correctly spelt word.
    (a) repitition
    (b) aggrravate
    (c) accomplish
    (d) hieghten
    Answer: (c)

17. Select the most appropriate synonym of the given word. INITIATE
    (a) sign
    (b) slow
    (c) start
    (d) show
    Answer: (c)

18. Select the correct active form of the given sentence. By whom were you taught Mathematics?
    (a) Who taught you Mathematics?
    (b) Who teaching you Mathematics?
    (c) Who will teach you Mathematics?
    (d) Whom are you teaching Mathematics?
    Answer: (a)

19. Select the most appropriate option to substitute the underlined segment in the given sentence.

If no substitution is required, select No improvement.

When we went to the cinema yesterday, <u>the film had already start.</u>
    (a) the film was already start.
    (b) the film had already started.
    (c) No improvement
    (d) the film have already start.
    Answer: (b)

20. Select the most appropriate antonym of the given word. PROLONG
    (a) prevent
    (b) shorten
    (c) allow
    (d) increase
    Answer: (b)

21. Select the word which means the same as the group of words given. Incapable of being read
    (a) unseen
    (b) eligible
    (c) illegible
    (d) vague
    Answer: (c)

22. Select the most appropriate option to fill in the blank. Following detailed deliberations, the meeting has been _____till next week
    (a) proposed
    (b) adjourned
    (c) reviewed
    (d) cancelled
    Answer: (b)

23. In the sentence identify the segment which contains the grammatical error. Having just taking a heavy lunch, she was not ready to have any fruit.

(a) to have any fruit.

(b) taking a heavy

(c) Having just

(d) she was not ready

Answer: (b)

24. Select the most appropriate option to fill in the blank. Hima Das, the reigning world junior sprinter who _____ the national record, won the gold in the Federation Cup.

(a) holds

(b) keeps

(c) plays

(d) gets

Answer: (a)

25. Select the most appropriate option to substitute the underlined segment in the given sentence.

If no substitution is required, select No improvement.

<u>I am think that tomorrow I will take</u> leave and stay at home.

(a) I have thought that tomorrow I am taking

(b) No improvement

(c) I think that tomorrow I will take

(d) I was thinking that the next day I will take

Answer: (c)

Answer key

Answer key as marked in the Staff Selection Commission's response sheet. "—" means the sheet did not show it clearly.

General Intelligence and Reasoning

1	**(c)**	2	**(c)**	3	**(c)**	4	**(d)**	5	**(b)**	6	**(a)**	7	**(a)**	8	**(a)**
9	**(a)**	10	**(b)**	11	**(b)**	12	**(b)**	13	**(c)**	14	**(a)**	15	**(b)**	16	**(c)**
17	**(a)**	18	**(a)**	19	**(c)**	20	**(d)**	21	**(c)**	22	**(c)**	23	**(d)**	24	**(a)**
25	**(b)**														

General Awareness

1	**(c)**	2	**(b)**	3	**(c)**	4	**(b)**	5	**(a)**	6	**(b)**	7	**(b)**	8	**(c)**
9	**(d)**	10	**(a)**	11	**(d)**	12	**(c)**	13	**(b)**	14	**(a)**	15	**(c)**	16	**(a)**
17	**(a)**	18	**(d)**	19	**(b)**	20	**(d)**	21	**(a)**	22	**(b)**	23	**(d)**	24	**(b)**
25	**(b)**														

Quantitative Aptitude

1	**(a)**	2	**(b)**	3	**(c)**	4	**(d)**	5	**(a)**	6	**(c)**	7	**(b)**	8	**(a)**
9	**(b)**	10	**(b)**	11	**(c)**	12	**(d)**	13	**(c)**	14	**(b)**	15	**(c)**	16	**(b)**
17	**(b)**	18	**(b)**	19	**(c)**	20	**(d)**	21	**(b)**	22	**(b)**	23	**(d)**	24	**(b)**
25	**(d)**														

English Comprehension

1	**(d)**	2	**(a)**	3	**(a)**	4	[illegible]	[illegible]	**(b)**	6	**(d)**	7	**(a)**	8	**(a)**
9	**(b)**	10	**(b)**	11	**(a)**	12	**(c)**	13	**(c)**	14	**(b)**	15	**(b)**	16	**(c)**
17	**(c)**	18	**(a)**	19	**(b)**	20	**(b)**	21	**(c)**	22	**(b)**	23	**(b)**	24	**(a)**
25	**(c)**														